(21/05/20)

This Maths practice session has 4 parts:

- (1) You will need to draw the arms of the clock to match the time that is given on the sheet.
- (2) There will be a number of rulers drawn on the sheet, your task will be to write down the correct measurement (marked blue) in centimetres and millimetres.
- (3) The third sheet has a target number on the left. You will have to find one square out of three which has three numbers which make a target number when added together.
- (4) The last sheet has a number of fraction subtraction tasks. After subtracting, it would be great if you could try to simplify them as well.

There are instructions written on every one of those sheets as well.

You do not have to complete all the tasks – you might only choose a few from each sheet.

It would be very good if, when finished, you could show the solutions to one of your parents.

Read the time under the clock and draw the hands in the clock.

1

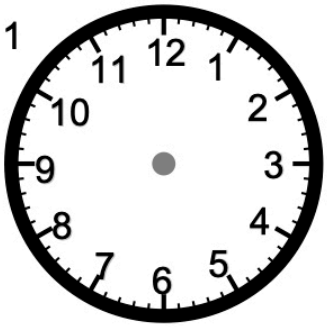

Time : 9:37 pm

2

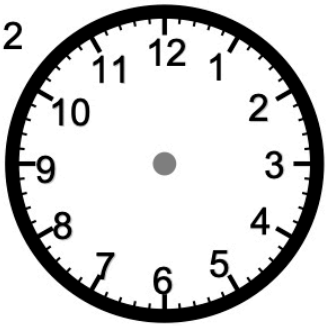

Time : 4:48 pm

3

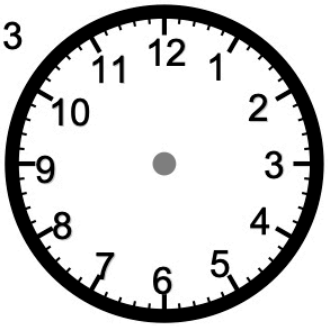

Time : 1:41 am

4

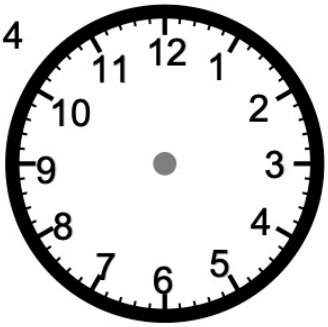

Time : 5:54 pm

5

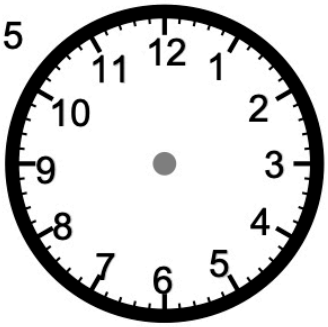

Time : 6:38 am

6

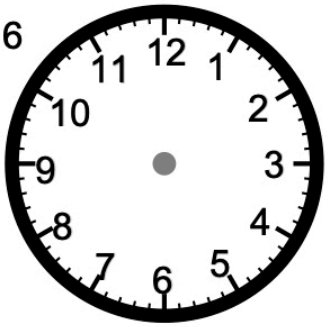

Time : 3:17 am

7

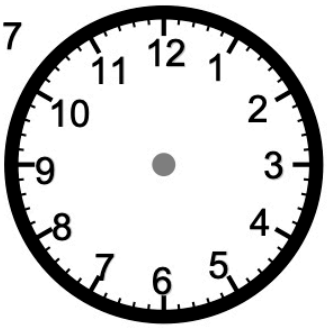

Time : 7:41 pm

8

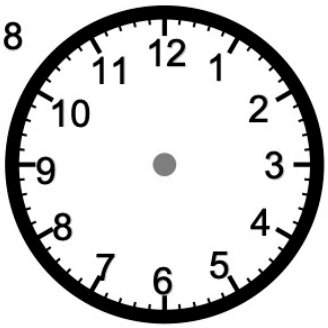

Time : 11:01 pm

9

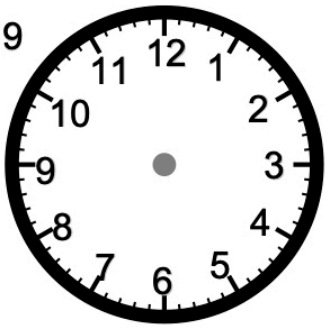

Time : 0:28 am

Read on the ruler the length of the line and write the length next to the ruler.

The length is:

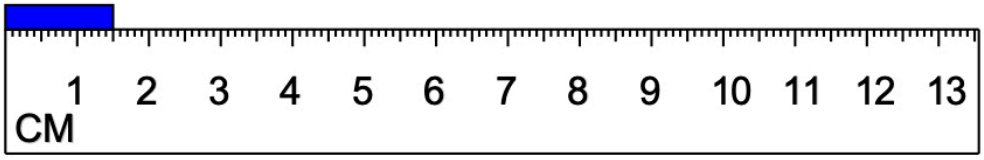

_____

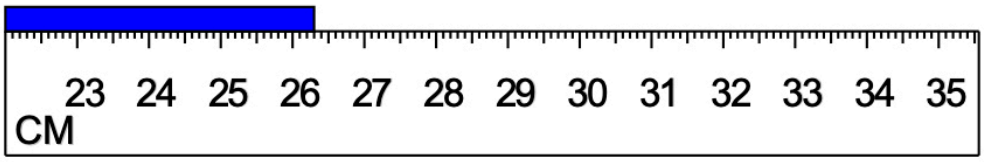

_____

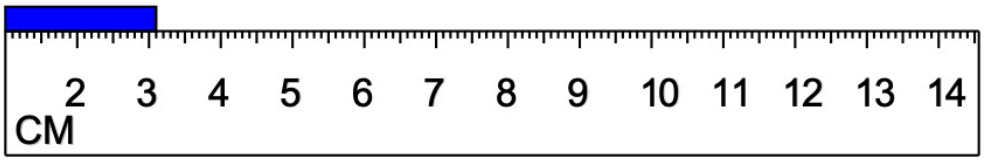

_____

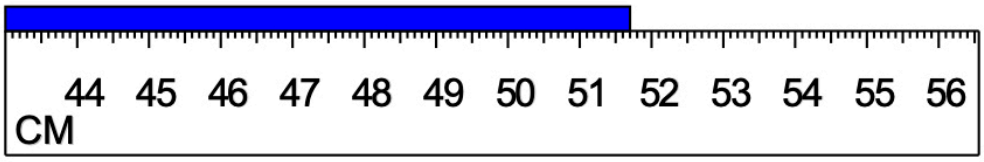

_____

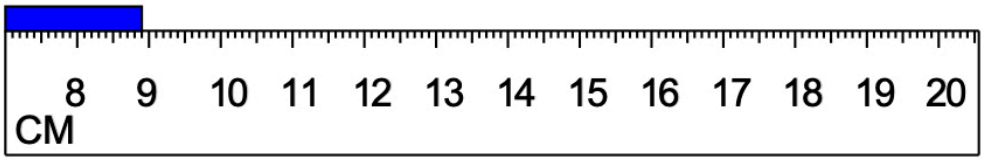

_____

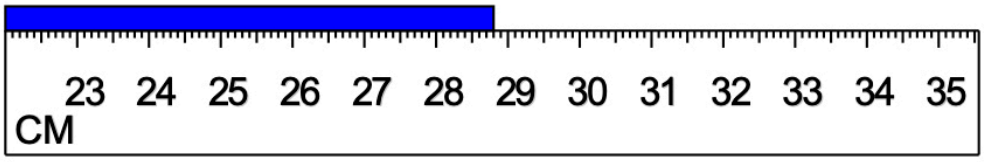

_____

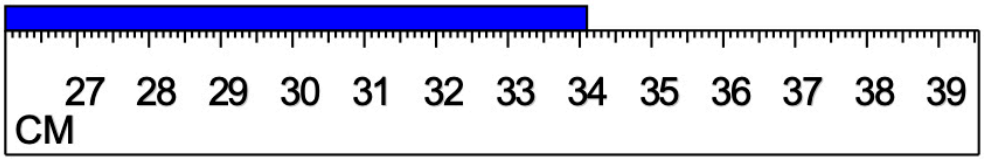

_____

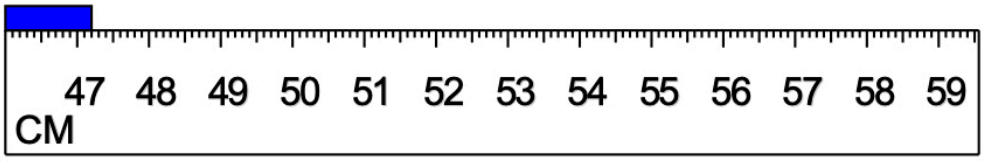

_____

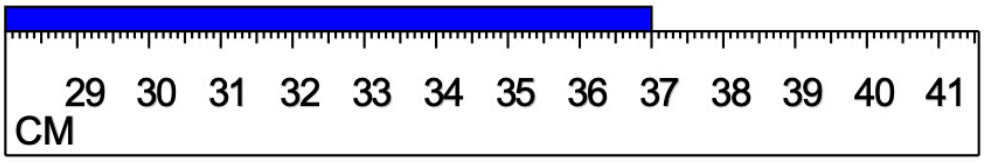

_____

Color the three numbers in one square that add up to the given sum.

119 =

57	41
31	31

30	40
55	33

31	50
51	28

126 =

66	37
36	34

33	59
34	55

36	48
43	36

221 =

68	75
68	73

73	66
81	73

72	80
69	81

221 =

70	86
65	67

62	95
74	70

71	93
58	79

200 =

86	57
57	83

55	57
65	90

66	77
60	64

How to subtract the fractions with the same denominator?

You can just subtract the top numbers (the numerators).
Check if you can simplify the fraction.

1. $\frac{20}{21} - \frac{3}{21} =$
2. $\frac{11}{12} - \frac{4}{12} =$
3. $\frac{9}{15} - \frac{7}{15} =$
4. $\frac{16}{18} - \frac{4}{18} =$
5. $\frac{13}{22} - \frac{8}{22} =$
6. $\frac{11}{11} - \frac{4}{11} =$
7. $\frac{18}{20} - \frac{10}{20} =$
8. $\frac{13}{18} - \frac{12}{18} =$
9. $\frac{14}{14} - \frac{6}{14} =$
10. $\frac{13}{19} - \frac{5}{19} =$